# GIOCHIAMO CON I DADI

**1** COLORA IL QUADRATO CON IL NUMERO CHE RAPPRESENTA LA QUANTITÀ DEI PALLINI IN OGNI DADO.



3 2



3 6



1 2



0 1



2 4



6 7



4 5



8 7



8 9



Scansionato con CamScanner

# LE RANE A COPPIE

**1** UNISCI CON UN FILO LE RANE CHE HANNO LO STESSO NUMERO.






OBIETTIVI • Riconoscere le cifre.

Scansionato con CamScanner